Surname	Centre Number	Candidate Number
First name(s)		0

GCSE

3601U10-1

S24-3601U10-1

TUESDAY, 18 JUNE 2024 – MORNING

DESIGN AND TECHNOLOGY

Unit 1
ENGINEERING DESIGN

2 hours

For Examiner's use only		
Question	**Maximum Mark**	**Mark Awarded**
1.	**10**	
2.	**10**	
3.	**15**	
4.	**20**	
5.	**20**	
6.	**25**	
Total	**100**	

3601U101
01

ADDITIONAL MATERIALS

In addition to this examination paper, you will need a calculator.

INSTRUCTIONS TO CANDIDATES

Use black ink or black ball-point pen. Do not use gel pen or correction fluid.

You may use a pencil for graphs and diagrams only.

Write your name, centre number and candidate number in spaces at the top of this page.

Answer **all** questions.

Write your answers in the spaces provided in this booklet. If you run out of space, use the additional page(s) at the back of the booklet, taking care to number the question(s) correctly.

INFORMATION FOR CANDIDATES

The number of marks is given in brackets at the end of each question or part-question. You are advised to divide your time accordingly.

The total number of marks available is 100.

You are reminded of the need for good English and orderly, clear presentation in your answers. The quality of your written communication, including appropriate use of punctuation and grammar, will be assessed in your answer to questions **5**(a) and **5**(c).

JUN243601U10101

© WJEC CBAC Ltd.

Examiner only

Answer **all** questions.

1. The image below shows a circuit board, manufactured using CNC (Computer Numeric Control).



(a) Describe **one** disadvantage of using CNC to manufacture a circuit board. [2]

.....

.....

.....

(b) Name the **four** CAM (Computer Aided Manufacture) machines shown below. [4]

			
.....	.....	.....	.....

© WJEC CBAC Ltd.

Examiner only

(c) Explain **two** advantages of additive CAM manufacture.

Advantage 1: .....

.....

.....

[2]

Advantage 2: .....

.....

.....

[2]

3601U101 03

© WJEC CBAC Ltd.

Examiner only

2. The image below shows a styrofoam concept model of a wireless computer mouse.



(a) Describe **one** advantage of using styrofoam when making prototype models. [2]

.....

.....

.....

(b) Explain **two** ergonomic considerations when modelling the computer mouse. [4]

Consideration 1: .....

.....

.....

Consideration 2: .....

.....

.....

© WJEC CBAC Ltd.

Examiner only

(c) Styrofoam carries the symbol below.



(i) State which of the 6Rs this symbol represents. [1]

.....

(ii) Polymers are often produced using crude oil. Circle the word below that best describes crude oil. [1]

Biodegradable **Non-renewable** **Renewable**

(iii) Manufacturers are moving away from oil-rich polymers and developing plant-based polymers. Explain **one** environmental advantage for this technological advancement. [2]

.....

.....

.....

3601U101 05

© WJEC CBAC Ltd.

Examiner only

3. The images below show a Bluetooth wireless shower speaker.

(a) State **two** important factors that would need to be considered when designing the Bluetooth wireless shower speaker. 2 × [1]

Factor 1: .....

Factor 2: .....

(b) Explain the advantages of using aluminium for the mesh on the Bluetooth wireless shower speaker. [4]

.....

.....

.....

.....

.....

.....

© WJEC CBAC Ltd.

Examiner only

(c) The image below shows the PCB used in the Bluetooth wireless shower speaker.



(i) State what the term PCB stands for. [1]

P ..... C ..... B .....

(ii) The image shows holes drilled in the PCB. State the reason why the manufacturer has used these on the PCB. [1]

.....

.....

(iii) Explain **one** reason for the use of SMT (Surface Mounted Technology) on the Bluetooth wireless shower speaker PCB. [2]



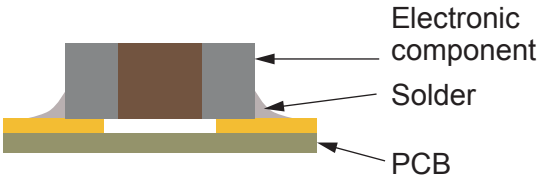

.....

.....

.....

3601U101 07

© WJEC CBAC Ltd.

Examiner only

(d) The images below show developments of the Bluetooth speaker. Study the images and analyse how the developments have had an impact on sales. [5]



Supports external memory card

The Bluetooth speaker is able to stick to the car window using a rubber sucker

.....

.....

.....

.....

.....

.....

.....

.....

.....

.....

© WJEC CBAC Ltd.

BLANK PAGE

PLEASE DO NOT WRITE ON THIS PAGE

© WJEC CBAC Ltd.

Examiner only

4. The image below shows a typical design and technology soldering iron station set-up.

(a) Analyse the safety of the soldering iron station set-up. [5]

.....

.....

.....

.....

.....

.....

.....

.....

.....

.....

© WJEC CBAC Ltd.

Examiner only

(b) The images below are of a typical soldering iron found in Engineering Design lessons.



(i) Describe the benefit, to the consumer, of using a soldering iron that carries the **CE** mark. [2]

.....

.....

.....

(ii) Explain **two** tests that would have been carried out to enable the soldering iron to gain a CE mark. 2 × [2]

Test 1: .....

.....

.....

Test 2: .....

.....

.....

3601U101
11

© WJEC CBAC Ltd.

Examiner only

(c) The image below shows a PCB precision drill and stand.



(i) The PCB precision drill stand makes use of a lever to operate it. Explain **one** benefit for this mechanical part. [2]

.....

.....

.....

(ii) Describe the impact of reducing the length of the lever arm when drilling. [2]

.....

.....

.....

(iii) Explain why cast iron is a suitable material for the base of the drill stand. [2]

.....

.....

.....

© WJEC CBAC Ltd.

Examiner only

(iv) Explain the basic process of casting. [3]

.....

.....

.....

.....

.....

© WJEC CBAC Ltd.

Examiner only

5. (a) The image below shows a bike tyre. Evaluate the use of Kevlar in bike tyres, compared to traditional rubber. [5]

Marks will be awarded for the content of the answer and the quality of written communication.

.....

.....

.....

.....

.....

.....

.....

.....

.....

© WJEC CBAC Ltd.

Examiner only

(b) The image below shows a bike hoist storage system.

(i) Explain **one** advantage of using nylon for the pulley wheels. [2]

.....

.....

.....

(ii) The bike hoist system below has a mechanical advantage of 4:1.

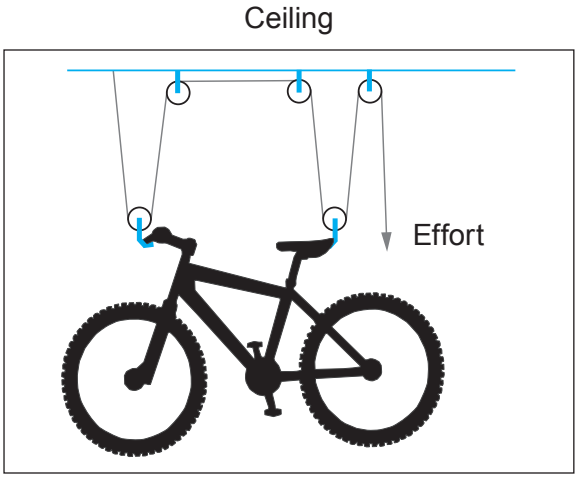

Bike = 140 N

Calculate the force required to lift the bike. [3]

Show all workings.

.....

.....

.....

.....

© WJEC CBAC Ltd.

Examiner only

(iii) If the rope is pulled 5 metres, how high has the bike been hoisted? [1]

.....

(iv) In the space below, use notes and sketches to design a safe mechanical method to enable the user to wind the cord in, rather than pulling it. [4]

© WJEC CBAC Ltd.

Examiner only

(c) The image below shows a ceiling bracket and pulley for the hoist. Evaluate the benefits of stamp pressing this component. [5]

Marks will be awarded for the content of the answer and the quality of written communication.

.....

.....

.....

.....

.....

.....

.....

.....

.....

© WJEC CBAC Ltd.

Examiner only

6. The image below is of a traffic safety cone with a light-activated warning lamp.

(a) The warning lamp casing is made from polyvinyl chloride (PVC). Explain **one** reason why PVC is a suitable material for the warning lamp casing. [2]

.....

.....

.....

(b) Analyse the circuit diagram below used in the warning lamp.

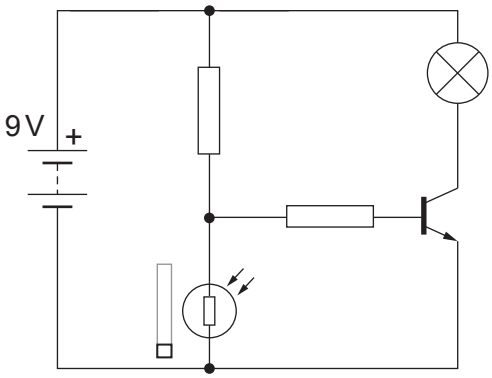

© WJEC CBAC Ltd.

Examiner only

(i) Name the input component: .....
[1]

(ii) Name the output component: .....
[1]

(iii) Describe the purpose of the transistor in the warning lamp circuit. [2]

.....

.....

(c) In the space below, show details of how the cone could be re-designed to make the lamp and cone one complete design. [6]

© WJEC CBAC Ltd.

Examiner only

(d) (i) Complete the circuit below, by adding the missing component, to allow the sensitivity to be adjusted and explain the reason for your choice of component. [3]

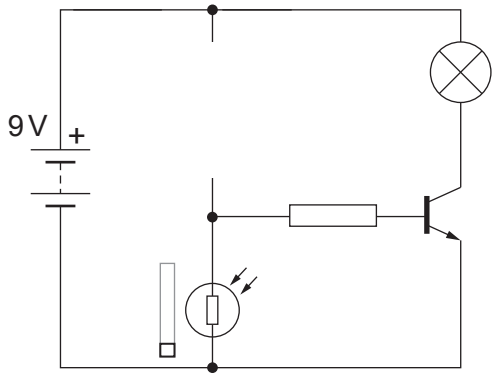

Reason:

.....

.....

.....

(ii) Use the diagram below. Calculate the voltage at V_{OUT}. [2]

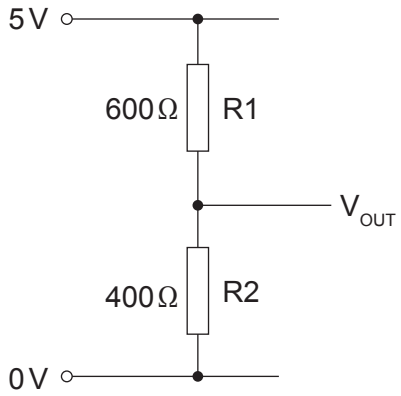

Show all workings.

.....

.....

.....

.....

© WJEC CBAC Ltd.

Examiner only

(e) (i) Name the logic gate below.

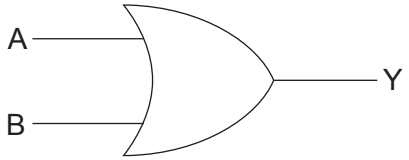

.....

[1]

(ii) Complete the truth table for an **AND** gate below. [4]

A	**B**	**Y**
0	0	
1	0	
0	1	
1	1	

© WJEC CBAC Ltd.

Examiner only

(iii) Using the **three** logic gate symbols shown below, complete the warning lamp logic diagram to meet its new specifications. [3]

New warning lamp specifications:

The warning lamp has been modified to come on:

- when the warning lamp sensor is in darkness
- between the hours of 7 pm and 7 am
- if an override switch is activated.

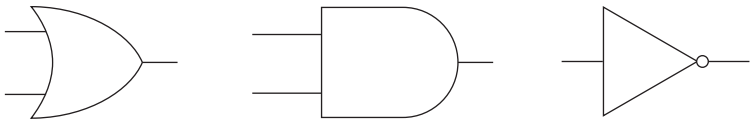

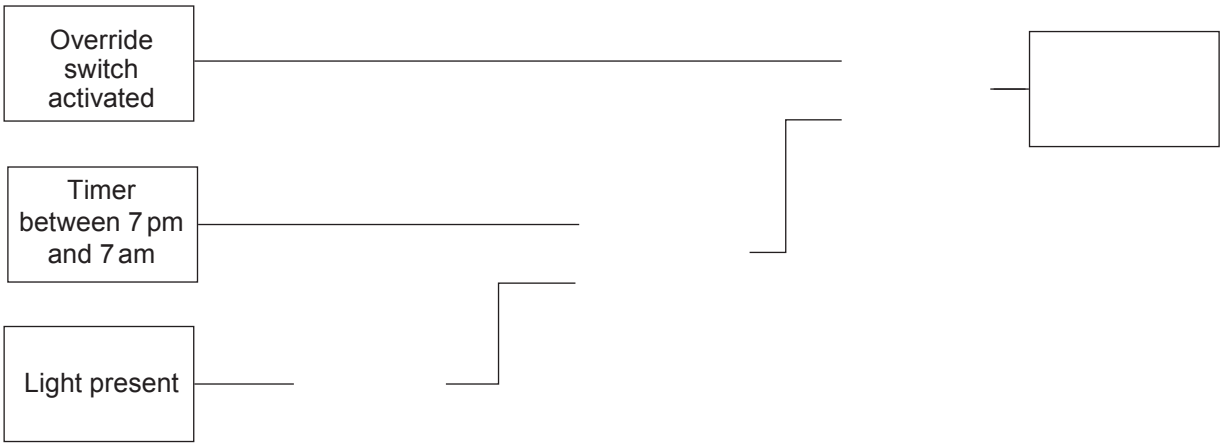

END OF PAPER

© WJEC CBAC Ltd.

Question number	Additional page, if required. Write the question number(s) in the left-hand margin.	Examiner only

© WJEC CBAC Ltd.

BLANK PAGE

PLEASE DO NOT WRITE ON THIS PAGE

© WJEC CBAC Ltd.